ClassMundo

Lados y vértices

Nombre: _____ Fecha: _____

Instrucciones: Observa cada figura geométrica. Cuenta sus lados y vértices y escribe las cantidades.

1.

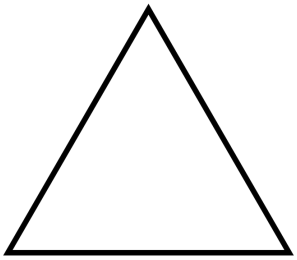

Lados:_____

Vértices:_____

2.



Lados:_____

Vértices:_____

3.



Lados:_____

Vértices:_____

4.

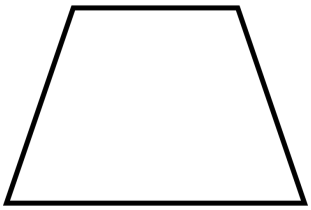

Lados:_____

Vértices:_____

5.

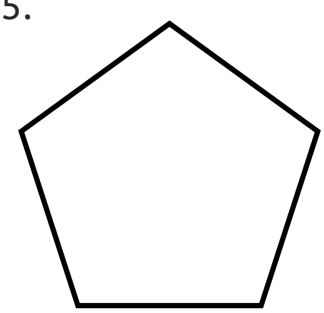

Lados:_____

Vértices:_____

6.

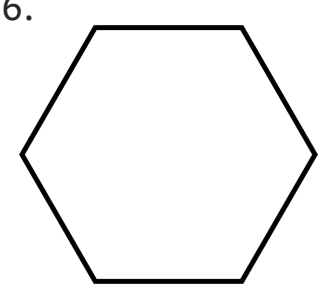

Lados:_____

Vértices:_____

7.

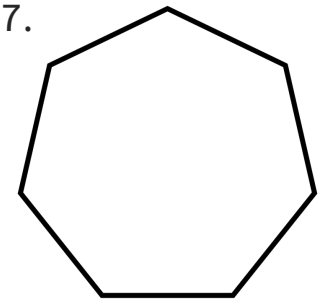

Lados:_____

Vértices:_____

8.

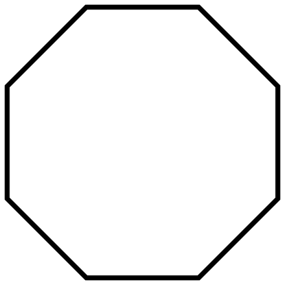

Lados:_____

Vértices:_____

ClassMundo

Lados y vértices

Nombre: _____ Fecha: _____

CLAVE DE RESPUESTAS

1.

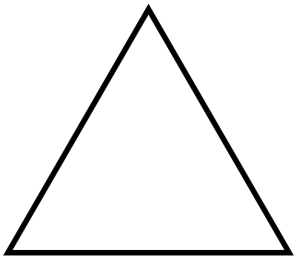

Lados: 3

Vértices: 3

2.



Lados: 4

Vértices: 4

3.



Lados: 4

Vértices: 4

4.

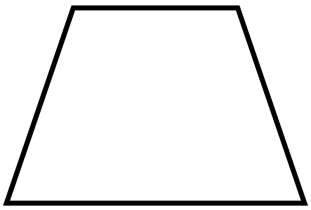

Lados: 4

Vértices: 4

5.

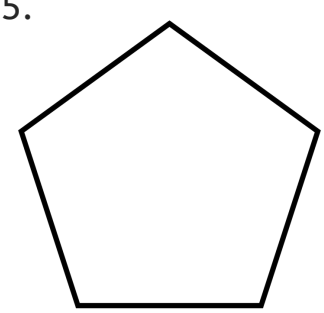

Lados: 5

Vértices: 5

6.

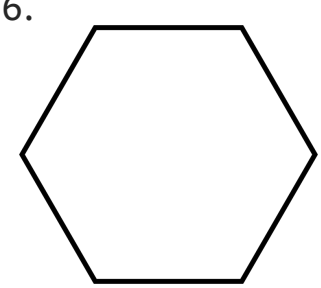

Lados: 6

Vértices: 6

7.

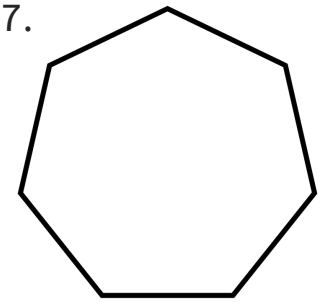

Lados: 7

Vértices: 7

8.

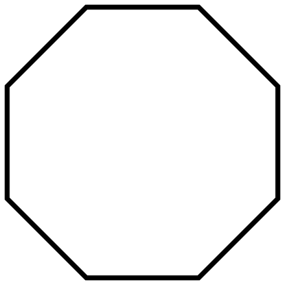

Lados: 8

Vértices: 8